Ας μετρήσουμε μπαλόνια

Μέτρησε τα μπαλόνια κάθε σειράς και γράψε πόσα είναι.

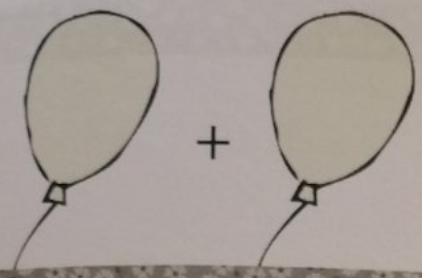

+ = ☐



+ = ☐



+ = ☐

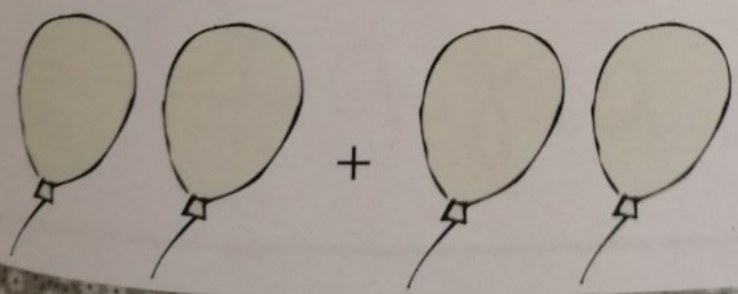

+ = ☐



+ = ☐